Name: _____ Primary 5-a-day Silver

1st February

11×11

$235 \div 5$

A teacher has 380 sweets.

She gives 9 children 6 sweets each.

How many sweets does the teacher have left?

Rob finishes school at half past three.
He then walks home and this takes twenty-five minutes.

Write the time he arrives home on the clock display.
Write the time as 24 hour time.

:

Group	Tally
Children	𝍸 𝍸 𝍸 ||
Adults	𝍸 𝍸 |
Pensioners	|||

An adult ticket costs £8
The price of a child ticket is half the price of an adult ticket.
Pensioners pay £1 less than adults.

How much money was raised?

© Corbettmaths 2017

Name: _____ Primary 5-a-day Silver

2nd February

$303 + 1{,}718$

$\frac{9}{11} - \frac{3}{11}$

Shade $\frac{7}{10}$ of this grid

Fill in the missing numbers

[ ] + [ ] = [ ]

multiple of 3 multiple of 4 multiple of 5

Each card on the left matches one on the right.

Draw lines to match the cards which are **equal** in value

8 x 8	6 x 7
9 x 5	16 x 4
21 x 2	15 x 3
52 x 1	13 x 4

© Corbettmaths 2017

Name: _____ Primary 5-a-day Silver

3rd February

$835 - 190$

62×7

Write these numbers in its correct place on the diagram

20 21 24 27

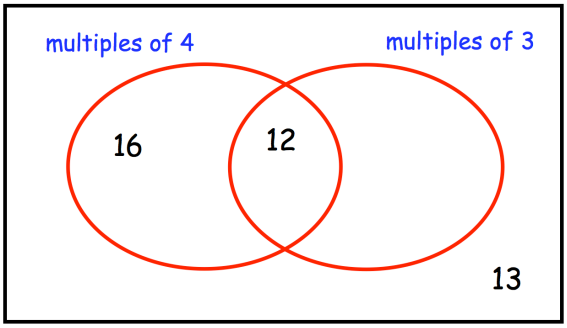

Write the number 3904 in words.

A carton of milk costs 67p

Find the cost of six cartons of milk

© Corbettmaths 2017

Name: _____ Primary 5-a-day Silver

4th February

$4.3 + 4.8$

17×100

This table shows the number of people who travelled to Bristol, London or Portsmouth from s train station.

	Thursday	Friday	Saturday
Bristol	256	240	201
London	450	473	322
Portsmouth	86	76	135

How many people travelled to **London** on **Saturday**?

How many people travelled to **Bristol** on **Thursday, Friday and Saturday** altogether?

How many **more** people travelled to **London** than **Portsmouth** on **Friday**?

How many people **travelled** on **Thursday?**

© Corbettmaths 2017

Name: _____ Primary 5-a-day Silver

5th February

$521 + 702 + 197$

$17 \times 6 = 200 - \square$

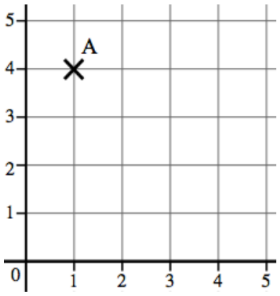

What is the coordinates of point A?

Daisy has eighteen **fifty pence** pieces

How much money does Daisy have in total?

Draw all the **lines of symmetry** on the rectangle



© Corbettmaths 2017